CENTRO EDUCATIVO VILLA DE ALCORCON **3º ESO**
CURSO ESCOLAR: 2019- 2020

TRABAJO MATEMÁTICAS TEMAS 8 Y 10

- Entregado a los alumnos el jueves 26 de Marzo de 2020
- Fecha de entrega por parte de los alumnos: 30 de Marzo de 2020
- Forma de entrega: mail rmgarciadelacruz@hotmail.com

1- Calcula h

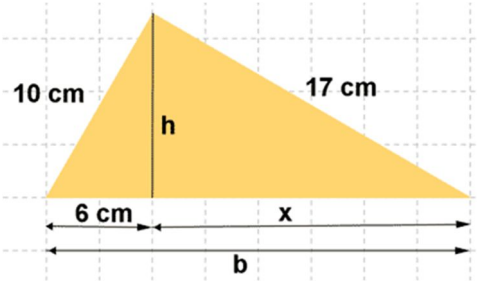

2- Halla el área de la parte coloreada sabiendo que el diámetro de la circunferencia grande es de 6 cm



3- Halla el área de la parte coloreada sabiendo que el diámetro de la circunferencia grande es de 6 cm

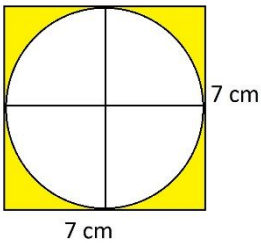

3- Calcula el área

a)

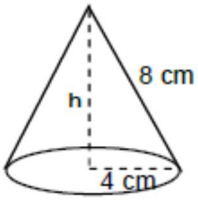

b)

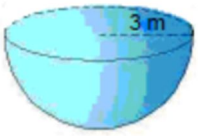

c)

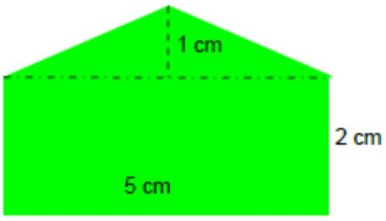

d)

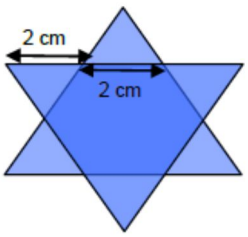

e)

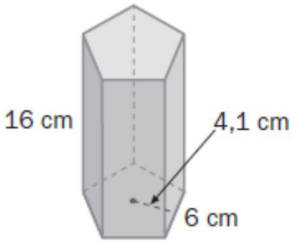

f)

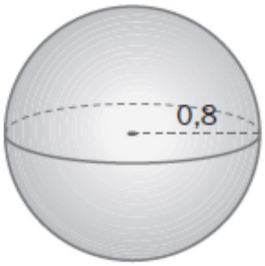

4- Calcula los volúmenes

a)

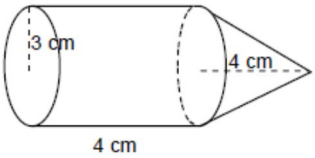

b)

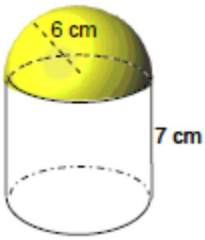

C)

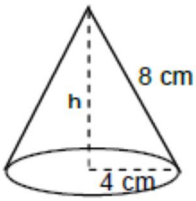

d)

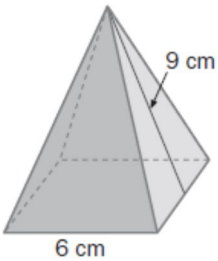
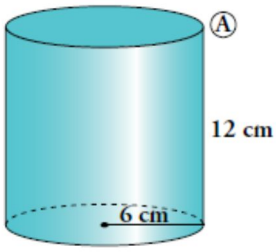
e)